Name:

Counting groups of 10

Counting by 10s
Worksheet 1

Count each group and write the 2-digit number in each box.
Count the sets of 10 by 10s, and then add the extra units. *Each line at the top has 10.

	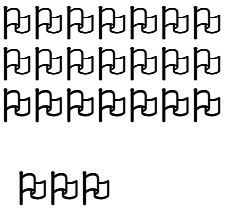	
		
		

10	20	30	40	50	60	70	80	90	100

©theclassroomkit.com